Checkpoint 3

1. Read the measure of the angles in the following figures.

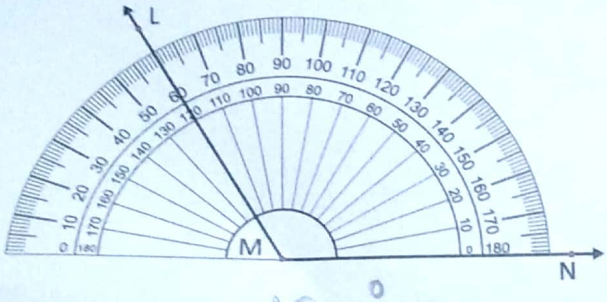

(a) $\angle LMN =$ 120°

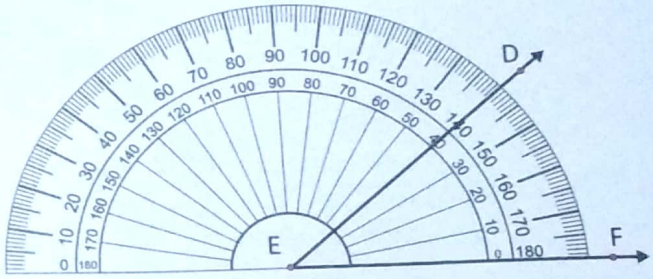

(b) $\angle DEF =$ 40°

Scanned with CamScanner

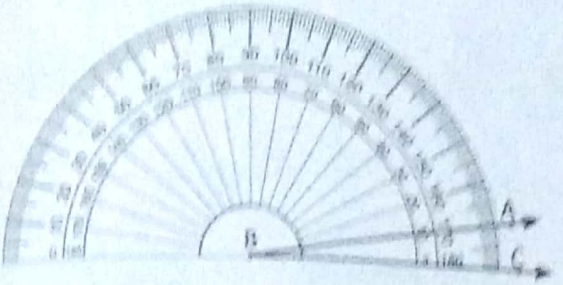

(c) ∠ABC = 10°



(d) ∠XYZ = 140°

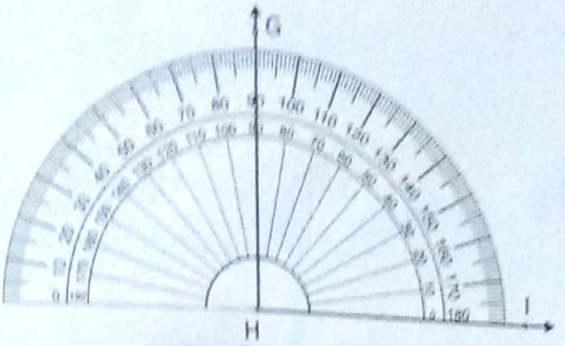

(e) ∠GHI = 90°

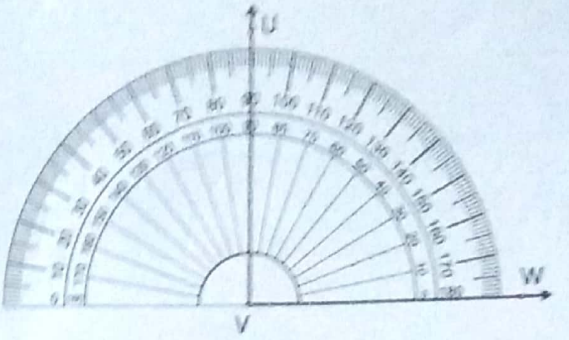

(f) ∠UVW = 90°

2. Measure the following angles and write if the angle is acute, obtuse or right angle triangle.

(a)

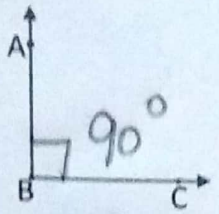

Right

(b)

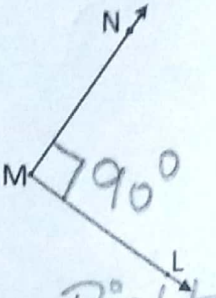

Right

(c)

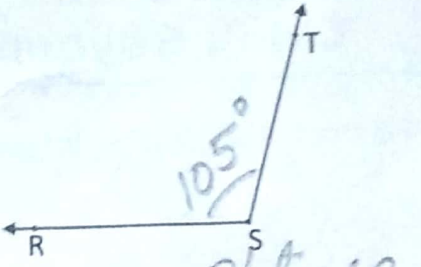

obtuse

(d)

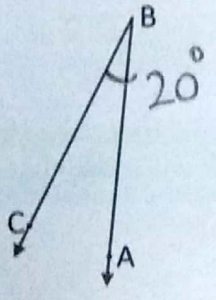

Acute

(e)

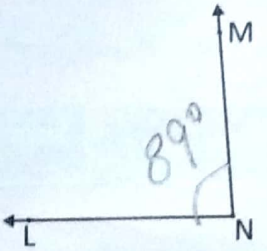

Acute

(f)

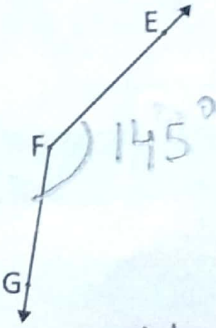

obtuse

(g)

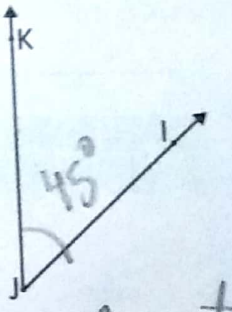

Acute

Scanned with CamScanner

Checkpoint 4

Do it in Math notebook

1. Using a protractor and ruler draw each of the following angles.

(a) $\angle ABC = 56^\circ$ (b) $\angle PQR = 110^\circ$ (c) $\angle DEF = 143^\circ$ (d) $\angle XYZ = 45^\circ$

(e) $\angle MON = 80^\circ$ (f) $\angle STR = 127^\circ$ (g) $\angle EFG = 160^\circ$

Skill Build 2

Scanned with CamScanner